KAMPALA PARENTS' SCHOOL 2004

PRIMARY SEVEN REVISION WORK
INTEGRATED SCIENCE – SET SEVEN

Name: _____ **Stream:** _____

1. Why are telephone wires left loose between poles?

   _____

2. Give one breed of chicken.

   _____

3. How does a drum produce sound when hit?

   _____

4. How are sweets dangerous to our teeth?

   _____

5. In which state of matter is water at 100°C?

   _____

6. Name the type of tooth shown in the diagram below.

   _____

7. Name the intestinal diarrhoeal disease caused by amoeba.

   _____

8. What is the importance of ossicles in the ear?

   _____

   _____

9. Why is heat necessary in a broader?

   _____

10. Give one natural process in plants which uses oxygen.

    _____

11. How do amphibians like frogs help in controlling malaria?

    _____

12. Write HIV in full.

    _____

13. Name the smallest unit of a living thing.

    _____

SECTION B

14. Below are diagrams of blood vessels. Use them to answer the following questions.

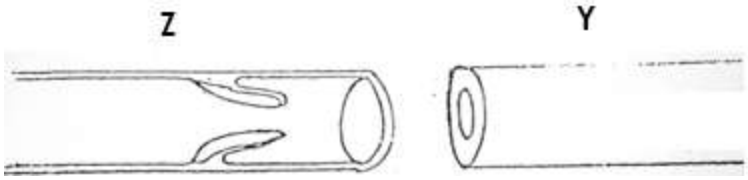

a) Name the type of blood vessel Z and Y

i) Z _____ ii)Y_____

b) Give one functional difference between blood vessel Y and Z.

_____

_____

c) To which body system do blood vessels above belong?

_____

15. a) What type of skeleton do the following organisms posses?

i) snail _____ ii) Newt _____

b) Name any one example of immovable joint in the human skeleton.

_____

c) How is the human skeleton important to circulatory system?

_____

16. Three liquids paraffin, mercury and water were put in a test tube and shaken. Then they were allowed to settle as shown below.

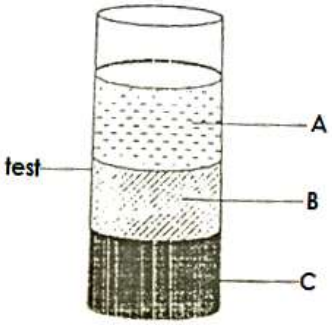

i) Name the liquid marked B and C.

a) B_____ b) C_____

ii) Why does liquid A settle on top?

_____

iii) Why does liquid C behave like that in the diagram above?

_____

***** END*****

KAMPALA PARENTS' SCHOOL 2004

PRIMARY SEVEN REVISION WORK
ENGLISH – SET SEVEN

Name: _____ Stream: _____

In each of the questions 1-10, Use the correct form of the words given in the brackets to complete the sentence

1. I have no _____to fight him. (strong)
2. _____is a sport. (swim)
3. The children would have passed if we _____them. (teach)
4. The widow could not help _____ when her loved one passed away. (weep)
5. Nankoli is _____of the two girls. (smart)
6. The old woman _____the wet clothes on the wire yesterday. (hang)
7. The examination was not so hard so we did it quite _____(easy)
8. Amooti sometimes behaves in a _____way. (child)
9. The guest served the food _____at the party. (self)
10. Our teachers talk with _____about our performance. (proud)

In questions 11-15, fill in the blank spaces with the correct word or group of words to complete the sentence.

11. Ambrose was not punished despite the fact that he came late. (Begin: Although……)

    _____

12. James enjoys playing football more than watching television. (Use:……would rather…..…..)

    _____

13. Immediately my mother arrived, I started eating the cake. (Use:……as soon as……..)

    _____

14. Mumpi is not as tall as Mulefu. (Use:……..than……..)

    _____

15. Alinda broke his leg. He was chasing a friend. (Use:……..while……)

    _____

16. The graph below appeared in the New Vision newspaper on 13th June 2020 indicating how different Television stations contributed towards the National COVID-19 Task Force. Study it carefully and answer the questions that follow in full sentences.

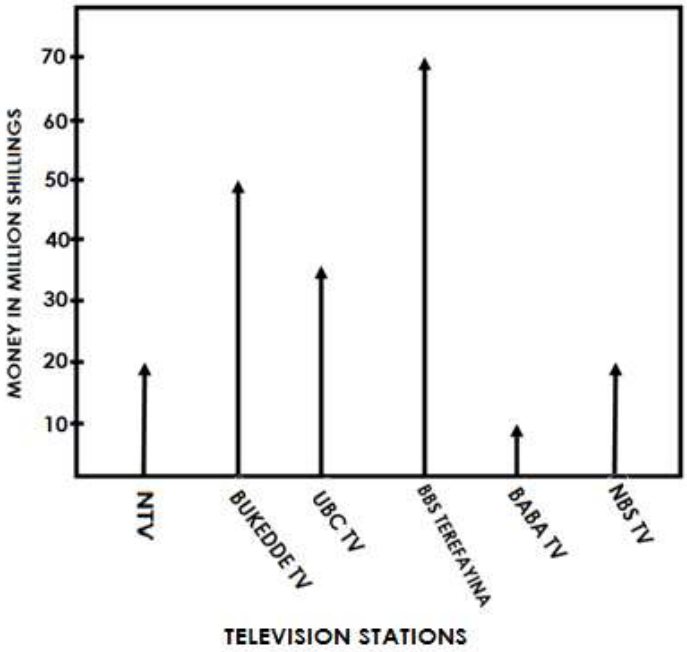

Questions

a) What does the above information show?

_____

b) Where was the information put?

_____

c) Who received the contribution?

_____

d) How much money did UBC TV contribute?

_____

e) How much more money did BBS Terefayina contribute than UBC TV?

_____

f) Why do you think these TV stations contributed towards the National COVID-19 Task Force?

_____

g) Which television station contributed the least amount of money according to the graph?

_____

h) Which television stations contributed the same amount of money?

_____

i) How many television stations contributed towards the COVID-19 cause?

_____

j) How much money was contributed by the television stations altogether?

_____

***** END*****

KAMPALA PARENTS' SCHOOL 2004

PRIMARY SEVEN REVISION WORK
SOCIAL STUDIES – SET SEVEN

Name: _____ **Stream:** _____

1. Apart from Kenya, name any other country in East Africa which was under Britain.

   _____

2. Give any one reason why people are being encouraged to plant cash crops in Uganda.

   _____

3. What role is played by parliament in the budget making process?

   _____

4. State one reason why the Common Wealth of Nations organizes games after four years.

   _____

5. What role is played by the prefect in charge of school compound?

   _____

6. Name any one hydro electric power station on R. Nile in Uganda.

   _____

7. State one way HIV/AIDS has contributed to low economic production in Uganda.

   _____

8. Name any two depression lakes found in the central plateau of Uganda.

i) _____

ii) _____

9. In which way did the LEGCO members contribute towards the independence of Uganda?

   _____

10. Name the major economic activity of Uganda.

    _____

11. Name the type of rain formed as a result of evaporation.

    _____

12. Give any two dangers of rainfall to people.

i) _____

ii) _____

13. Give any one reason why people are being encouraged to plant cash crops in Uganda today.

    _____

14. Give one problem faced by Pan-Africanists during the struggle for independence.

_____

RELIGIOUS EDUCATION

15. Give one reason why the Jews were against Jesus Christ.

_____

16. Name the pillar that makes one a Muslim.

_____

17. Mention two things that helped Jesus to keep his father's glory on earth.

i) _____

ii) _____

18. State two ways you as a Muslim child can relate with others.

i) _____

ii) _____

19. What is PBUH in full?

_____

20. Name any one dangerous result of betraying in Christian life.

_____

***** *END*****

KAMPALA PARENTS' SCHOOL 2004

PRIMARY SEVEN REVISION WORK

MATHEMATICS – SET SEVEN

Name: _____ **Stream:** _____

1. Subtract 2g + h from 2g – h.

2. Divide: $\frac{2}{3} \div \frac{2}{9}$

3. The diagonals of a rhombus are 8cm and 6cm respectively. Calculate the perimeter of the rhombus.

4. Write CMLXXIV in words.

5. The diagram below shows a cylinder of radius 28dm.

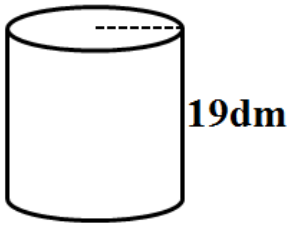

a) Calculate the volume of the cylinder.

b) Find the surface area of the cylinder.

6. A rectangular room measuring 49cm along the length and 30cm along the width. A carpet is placed in the room leaving 5cm to reach the wall from all sides as shown below.

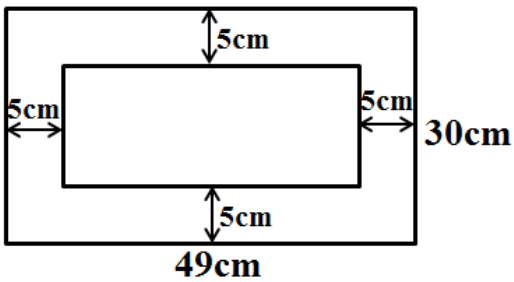

a) Find the area of the carpet.

b) Find the area of the room.

c) Find the area of the room left uncovered by the carpet.

7. The perimeter of a rectangular field is 72cm. If the length is twice the width, find the area of the field.

8. In a class, there are 20% more girls than boys. If the boys are 108,

a) Find the total number of pupils in class.

b) How many more girls than boys are there?

9. At a forex bureau. 1 US dollar costs Ug.sh. 3650.

a) How much Ug.sh. will a tourist who has US dollar 650 get?

b) If a business man had Ug.sh. 821,250, how much US dollar will he get at the same exchange rate?

10. a) Solve: $-1(k - 2) = (5k - 2)$

b) Solve $2y - 3(1 - y) = 7$

11. Given that the mean of five consecutive positive integers is 8 and the first integer is w.

a) Find the value of w.

b) Write the five integers.

***** END *****